Name: Class:

# Addition Problems

## Farm Animals Edition

Instructions: Read the addition problem. Solve the problem by writing the number sentence correctly.

**There are** 23 pigs in the barn, and 16 **more** pigs **join** them. **How many** pigs **are there now**?



____ + ____ = ____

Farmer Alex **has** 35 rabbits. Farmer Joe **has** 32 rabbits. **How many** rabbits do they **have** altogether?



____ + ____ = ____

Farmer Kate **has** 60 chickens in the coop. One day, her uncle **gives** her 18 **more** chickens. **How many** chickens **are there** now?



____ + ____ = ____

Farmer Tim **has** 57 goats in the barn, and his friend **gives** him 36 **more** goats. **How many** goats **are** in the barn **now**?



____ + ____ = ____

Farmer Bob **has** 74 turkeys in the coop, and his neighbour **gives** him 26 **more** turkeys. **How many** turkeys **are** in the coop **now**?



____ + ____ = ____

**There are** 17 ducks playing around the pond, and 16 more ducks **join** them. **How many** ducks **are there** now?



____ + ____ = ____

**There are** 47 horses in the stable, and 28 **more** horses come to **join** them. **How many** horses **are** in the stable **now**?



____ + ____ = ____